K8Worksheets

Missing Numbers

WS #2

What numbers do the letters in each number line represent?

1)

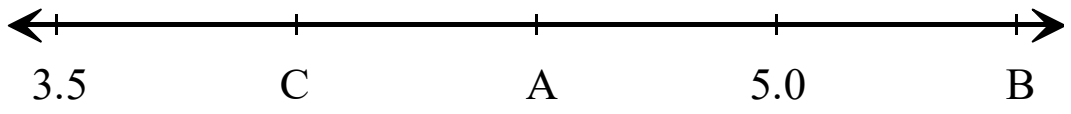

A =	B =	C =

2)



A =	B =	C =

3)

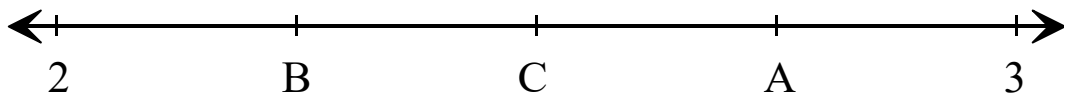

A =	B =	C =

4)



A =	B =	C =

© k8worksheets.com